Expressing Inequalities on a Numberline

Name:

Use the numberline to express the inequality.

Ex) $X \geq -27$

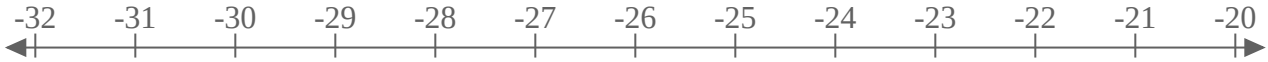

1) $X < 140$

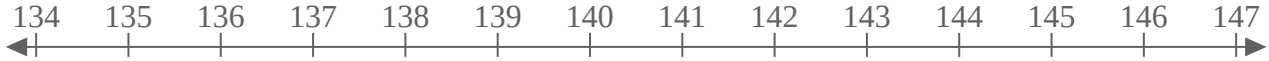

2) $X \leq 54$

3) $X \leq -190$

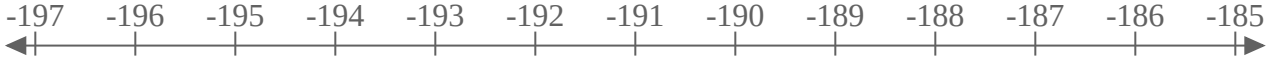

4) $X < -120$

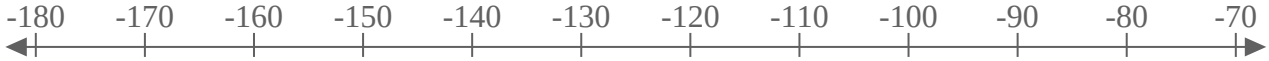

5) $X \geq 117$

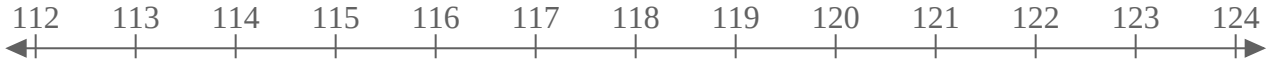

6) $X \leq 50$

7) $X \geq -70$

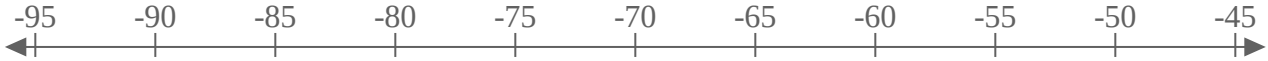

8) $X > 35$

9) $X > -170$

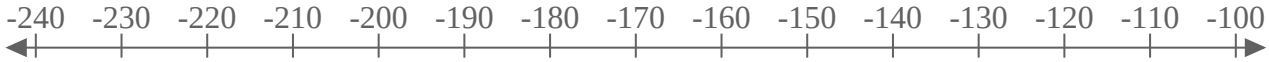

10) $X > -150$

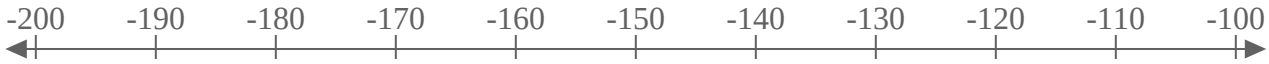

11) $X > -90$

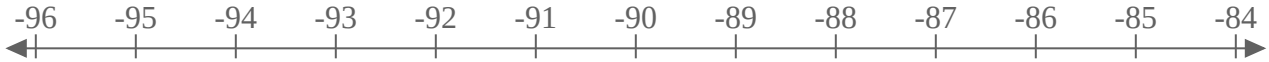

12) $X \geq 65$

13) $X > -5$

1-10	92	85	77	69	62	54	46	38	31	23
11-13	15	8	0							

Expressing Inequalities on a Numberline Name: **Answer Key**

Use the numberline to express the inequality.

Ex) $X \geq -27$

1) $X < 140$

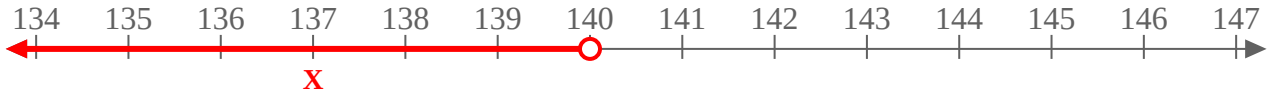

2) $X \leq 54$

3) $X \leq -190$

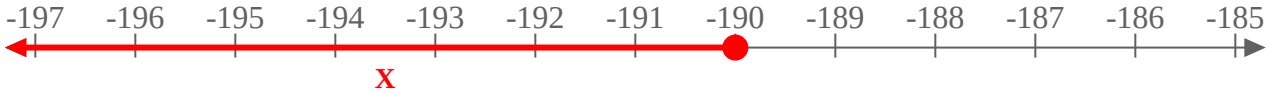

4) $X < -120$

5) $X \geq 117$

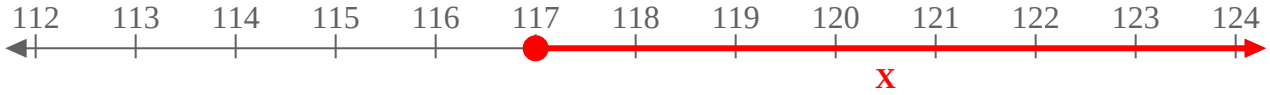

6) $X \leq 50$

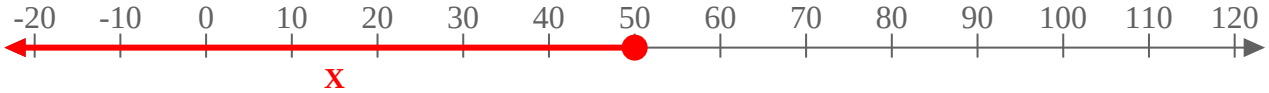

7) $X \geq -70$

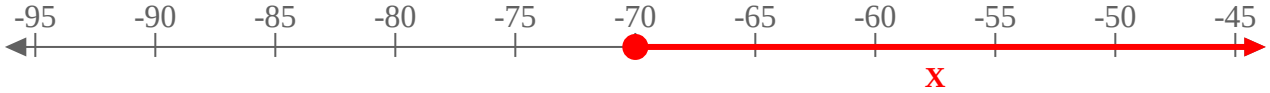

8) $X > 35$

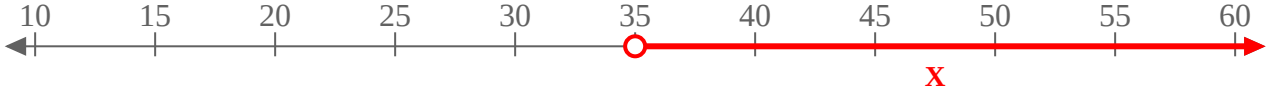

9) $X > -170$

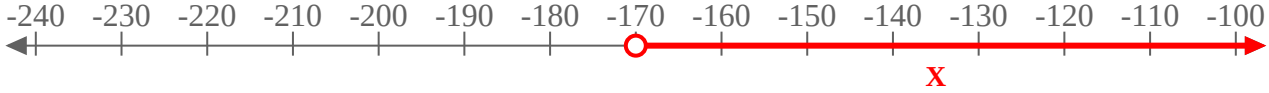

10) $X > -150$

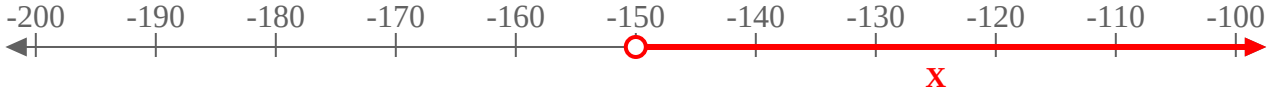

11) $X > -90$

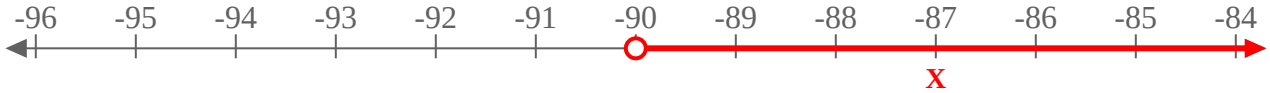

12) $X \geq 65$

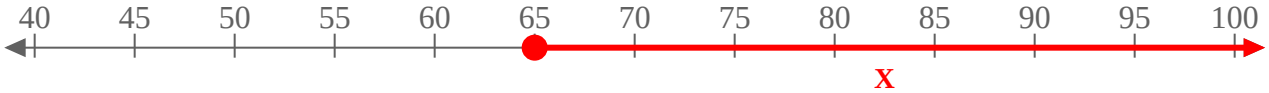

13) $X > -5$

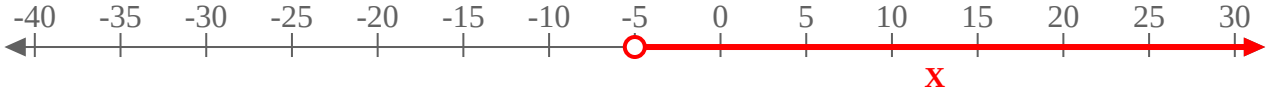

1-10	92	85	77	69	62	54	46	38	31	23
11-13	15	8	0							